Examination number .....

THE UNITED REPUBLIC OF TANZANIA
PRIME MINISTER'S OFFICE
REGIONAL ADMINISTRATION AND LOCAL GOVERNMENT
TABORA MUNICIPAL COUNCIL
FORM TWO DISTRICT ASSESSMENT
GEOGRAPHY

013
TIME2:30HRS

SEPTEMBER,2026

INSTRUCTIONS

1. This paper consists of section A, B and C with a total of 10 questions
2. Section A carries fifteen (15) marks section B carries (70) and section C carries fifteen (15) marks
3. Answer all question in section A,B and C
4. Write your number at the top of every page of your answer sheet.

SECTION A (15 marks)

Answer all questions in this section

1. For each of the item (i) –(x) choose the correct answer from among the given altenative and write its letter.

i) The two major branches of geography need geographical skills and techniques that covered under the technique known as.
   A. Human geography
   B. Remote sensing geography
   C. Practical geography
   D. Photograph geography

ii) The side of the folds are called
   A. Faults
   B. Land forms
   C. Limbs
   D. Anticline

iii) A natural solid materials composed of various minerals in different ratios are known as
   A. Rocks
   B. Alluvium
   C. Granite rock
   D. Photonic rock

iv) Equal length of the day and night geographically is known a
   A. Aphelion
   B. Perihelion
   C. Solstice

Shulelibrary.com

CamScanner

D. Equinox

v) What process is mainly responsible for gradually breaking large rocks into smaller pieces over the year
   A. Mass wasting
   B. Erosion
   C. Weathering
   D. Deposition

vi) What do the closely spaced contour lines on a map indicate
   A. Gentle slope
   B. Step slope
   C. Flat terrain
   D. Deposition

vii) The inner core is solid despite extremely high temperature. What is the reason for this situation.
   A. The inner core is made of light weight materials
   B. High pressure at the earth`s centre keeps the core solid
   C. Heat is not enough to melt the inner core
   D. Earth`s rotation preventing melting

viii) The piece of land surrounded by water is called
   A. Mid ocenic ridge
   B. Island
   C. Trench
   D. Continent

ix) The mountains formed by cooling and solidification of hot molten materials from the earth`s interior are called
   A. Block mountains
   B. Volcanic mountains
   C. Fold mountains
   D. Residual mountain

x) An alternating layer of different types of rocks in the earth`s surface / crust is known as
   A. Escarpment
   B. Arranged layers
   C. Strata
   D. Zones

2. Match the items in column A with the corresponding item in column Bby writing the letter

Shulelibrary.com

CamScanner

Examination number .....

COLUMN A	COLUMN B
i) Evidence to prove that the shape of the earth is slightly flattened.	A. Orbit
ii) The finth largest planet in the solar system	B. Milky way galaxy
iii) It generates heat and light that are essential for life.	C. Circumnavigation of the earth
iv) 150 millions kilometers	D. Location of the earth from the sun
v) A galaxy that contain our solar system	E. Earth
	F. Solar eclipse
	G. revolution

I.	II.	III.	IV.	V.

SECTION B (70 marks)

3. Atuganile was standing on a clift observing a very large body of salty water that covers a large part of the earth and lies between continents.
   a. What is the name of that features?
      .....
      .....
   b. List five (5) example of the feature mentioned in @above
      .....
      .....
      .....
      .....
      .....
      .....
      .....
      .....
4. When travelling in a fast moving vehicle you will see trees and other objects moving in opposite direction, basing on this observation outline five (5) evidences which show that the earth is rotating.
   .....
   .....
   .....
   .....

Shulelibrary.com

CamScanner

Examination number .....

.....

.....

5. Each continent has its unique geographical features, and the surface of any continent is not regular in shape and elevation. From the concept you know about the continent mention five (5) main relief feature of the continent.
6. A drainage pattern is the arrangement created by rivers and their tributaries within a specific drainage basin mention five (5) types of drainage pattern.
7. a. Define volcanism

   .....

   .....

   b. Name six positive influence of volcanism

   i) .....
   ii) .....
   iii) .....
   iv) .....
   v) .....
   vi) .....

8. Juma , a form two student he wants to use the library and reliable online sources to get information on map reading and interpretation . but has no any idea about map knowledge. As competent student in map reading and interpretation

   a) With examples list down types of maps

   .....

   .....

   .....

   .....

   .....

   .....

   .....

   .....

   .....

   .....

   b) Mention ways use to represent scales on the map

   .....

   .....

Shulelibrary.com

CamScanner

Examination number .....

.....

.....

.....

.....

c) What are the names of the following methods of showing relief features

(i) 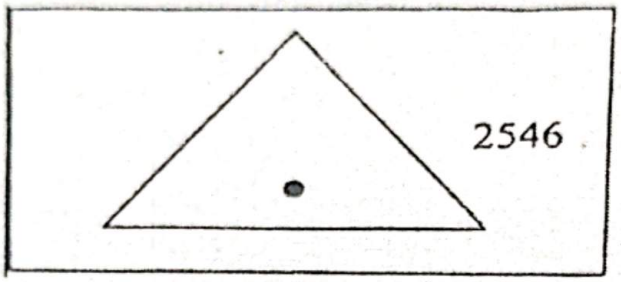

.....

(ii) 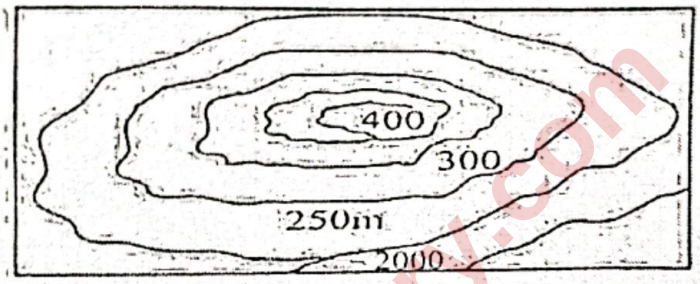

.....

(iii) 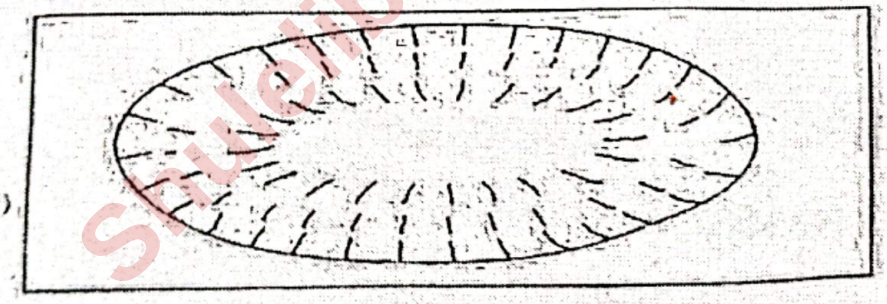

Studylibrary.com

9. Caren and Collin were observing the photograph showing a man working in a maize farm, using a hand hoe.

a) Identify the economic activity shown in that photograph

.....

.....

.....

.....

CamScanner

Examination number .....

.....

.....

b) Suggest the scale of the farming system

.....

.....

.....

.....

.....

.....

c) State two importance of this activity to the community

d) .....

.....

e) .....

.....

f) .....

.....

SECTION C (15 marks)

10. Classify three (3) types of rock according to the mode of formation and then provide three importance of rocks to human kind.

.....

.....

.....

.....

.....

.....

.....

.....

.....

.....

.....

.....

Shulelibrary.com

CamScanner